Name: _____ Primary 5-a-day Silver

12th February

$\frac{1}{8}$ of 160

9×53

Show the temperature –7°C on the thermometer with an arrow

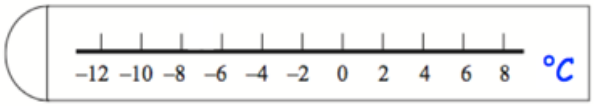

At a concert, each drink costs 60p.

Noah buys 4 drinks and pays with a £5 note.

How much change does he get?

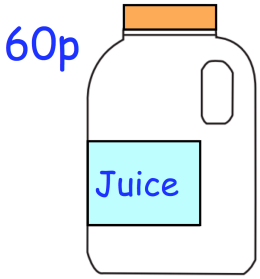

Three blocks are placed together

Find the total length of the three blocks

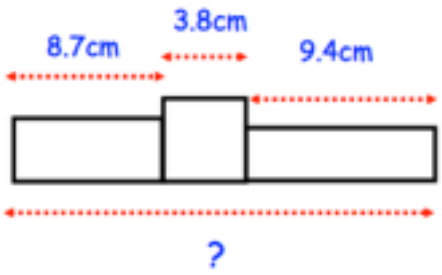

© Corbettmaths 2017