Name: _____ Primary 5-a-day Bronze

17th May

$300 - 50$

2×35

Match each shape to its name.

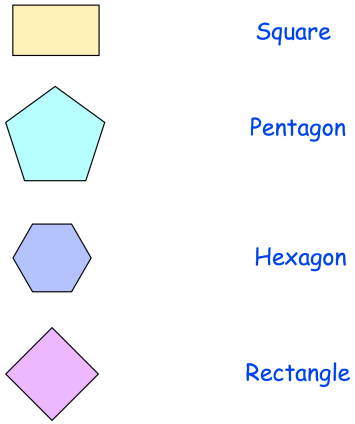

How many sides does an octagon have?

Show the time 7 o'clock

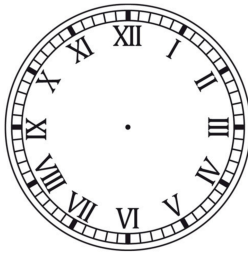

© Corbettmaths 2017

Name: _____ Primary 5-a-day Bronze

17th May

$300 - 50$

2×35

Match each shape to its name.

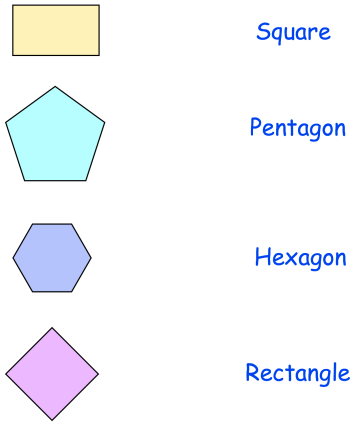

How many sides does an octagon have?

Show the time 7 o'clock

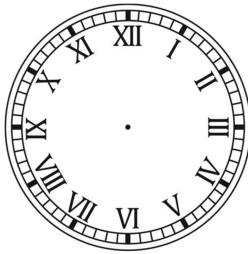

© Corbettmaths 2017