Name: _____ Primary 5-a-day Bronze

14th November

$163 - 9$

$23 + 24 + 25$

There are 82 people on a train.

At the next station, 25 people **get off the train** and 36 **get on the train**.

How many people are on the train **now**?

What fraction of the shape is unshaded?

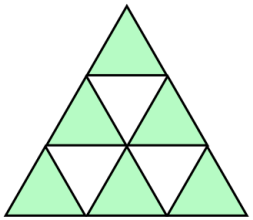

Show the time **quarter** to **three** on the clock

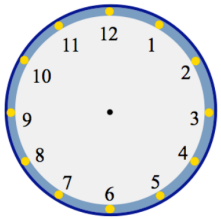

Name: _____ Primary 5-a-day Bronze

14th November

$163 - 9$

$23 + 24 + 25$

There are 82 people on a train.

At the next station, 25 people **get off the train** and 36 **get on the train**.

How many people are on the train **now**?

What fraction of the shape is unshaded?

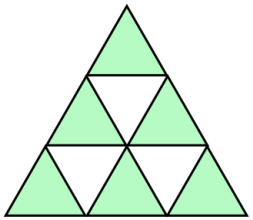

Show the time **quarter** to **three** on the clock

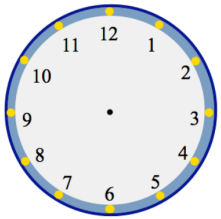

© Corbettmaths 2017 www.corbettmaths.com